ANDALUS INTERNATIONAL SCHOOLS
مدارس الأندلس العالمية

NAME : _____

CLASS : _____

DATE : _____

G3 Ch6:L3
11 Questions

1.

Each place has its own weather pattern.

A ✓

B ✗

2.

The Sun heats up areas near the poles more than areas near the equator.

A ✓

B ✗

3. 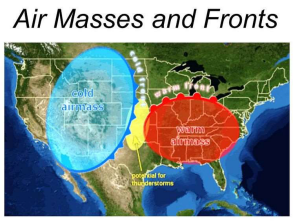

A _____, _____ air mass brings cold weather with snow.

A cold, dry

B cold, wet

C warm, dry

D warm, wet

4. 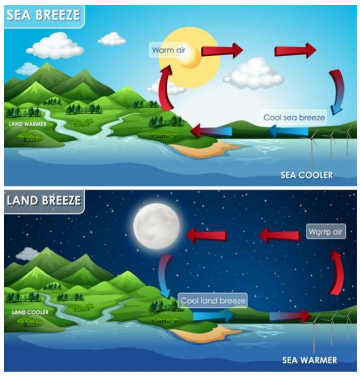

The sun heats both land and water, but the land cools down faster than water.

A

B

5. 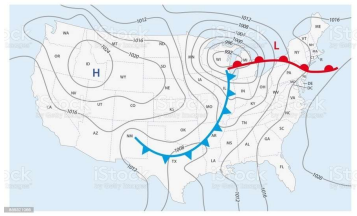

In the weather map; the warm front is shown by a _____ line with half circles.

A Blue.

B Green.

C Purple.

D Red.

6.

The temperature at the top of a mountain is usually warmer than the temperature at the bottom of the mountain because it's close to the sun.

A

B

7.

_____ is the place where two air masses meet when they move into each other.

A Left.

B Right.

C Front.

D Back.

8.

_____ it helps you know what the weather is like in an area.

A Weather map.

B Weather key.

C Weather graph..

D Weather draw.

9.

What do you think the weather in this photo is like?

A Cold

B Dry

C Wet.

D Rainy.

10.

All deserts are _____.

A Hot.

B Cold.

C Wet.

D Dry.

11.

_____: An imaginary line that lies halfway between the north and south poles.

A Latitude.

B The Equator.

C Altitude.

D Longitude.

Answer Key

1.a	2.b	3.b	4.a
5.d	6.b	7.c	8.a
9.a, c	10.d	11.b	